Name

Function Domain/Range Definition - Words to Number Line (With Union)



1 Which number line shows this domain?

All real numbers less than 7 OR greater than or equal to 8

A

B

2

All real numbers greater than -9 and less than or equal to -5 OR greater than -1 and less than 3

Which number line shows this domain?

A

B



3 Which number line shows this range?

All real numbers less than 1 OR greater than 2

A

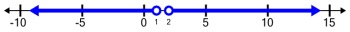

B

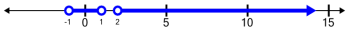

4 Which number line shows this domain?

All real numbers less than 3 OR greater than or equal to 6

A

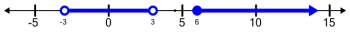

B

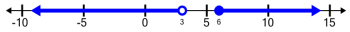

5

All real numbers greater than or equal to -9 and less than -6 OR greater than -4

Which number line shows this domain?

A



B

6

All real numbers less than or equal to 6 OR greater than 8 and less than or equal to 10

Which number line shows this domain?

A

B

7

All real numbers greater than -2 and less than or equal to 1 OR greater than or equal to 5 and less than or equal to 10

Which number line shows this range?

A

B

8

All real numbers greater than or equal to 0 and less than or equal to 6 OR greater than 7 and less than or equal to 10

Which number line shows this domain?

A
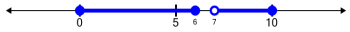
B