Name

Data and Graphs - Intro

1 How many kids like lollipop as a treat?

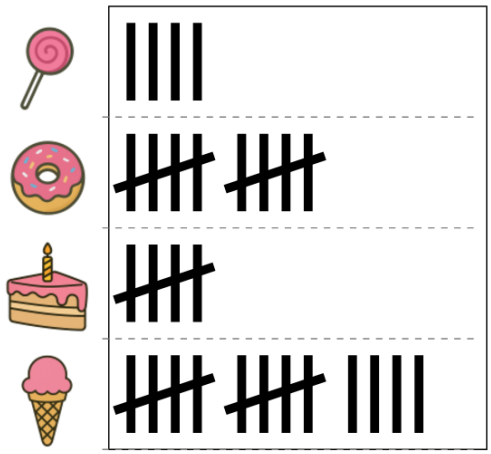

A	B	C
2	5	0
D	E	F
11	7	4

2 How many total children were surveyed?



A	B	C
25	18	21
D	E	F
10	14	13

3 What transportation type do 8 children like?

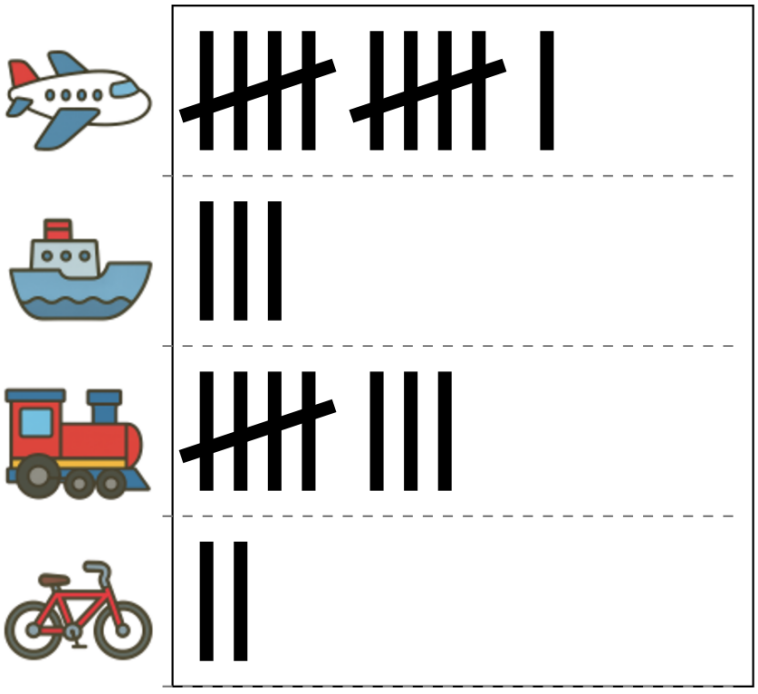

A	B	C	D
Train	Bike	Plane	Ship

Name

Data and Graphs - Intro

4 What treat do the SMALLEST number of children like?



A Donut

B Lollipop

C Cake

D Candy

5 What transportation type do the LARGEST number of children like?

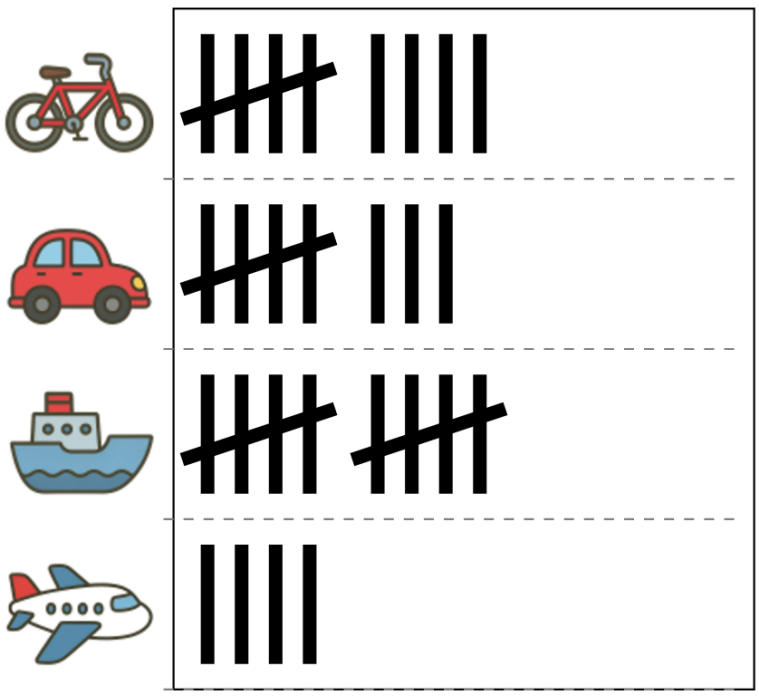

A Plane

B Bike

C Car

D Ship

Name

Data and Graphs - Intro

6 Do more kids like orange or banana as a fruit?

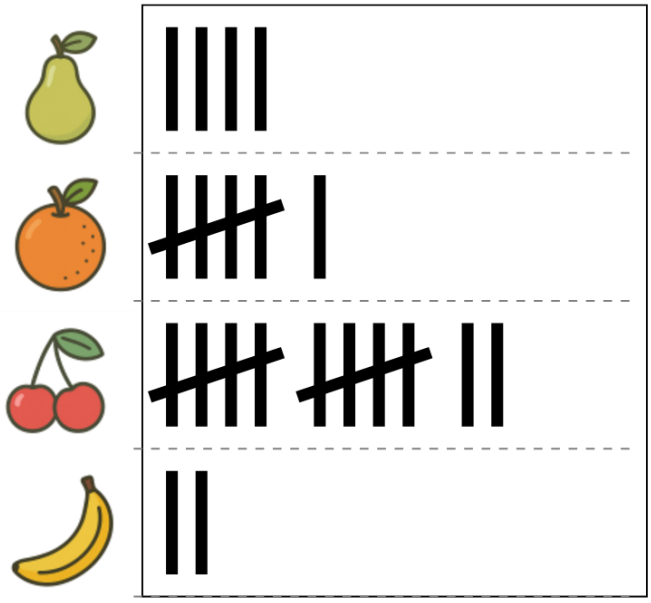

A

Banana

B

Orange

7 How many kids have either a fish or a bird as a pet?

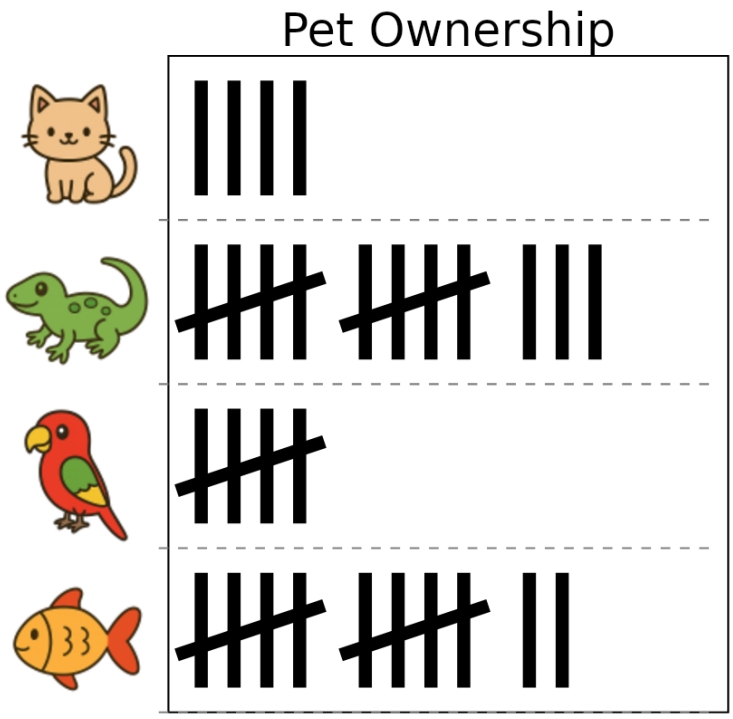

A

20

B

11

C

17

D

22

Name

Data and Graphs - Intro

8 How many more kids have a cat than a bird as a pet?

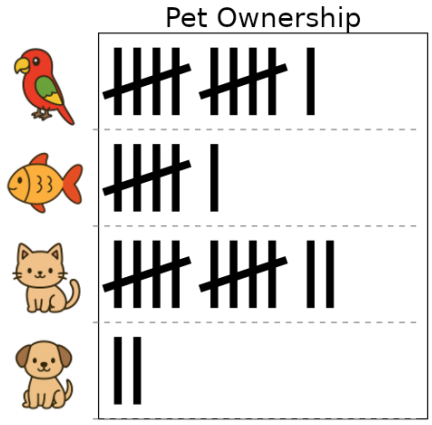

A 5	B 1	C 2
D 3	E 4	

9 How many hamburgers were sold on Monday?

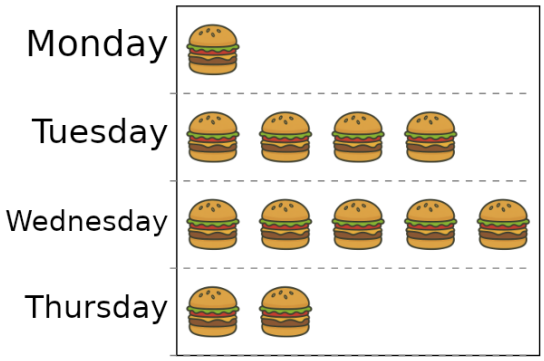

= 1 Hamburger

A 7	B 4	C 1
D 5	E 6	F 3

10 Who made 4 free throws?



= 1 Free Throw

- A Carter
- B Alyssa
- C Evan
- D Maya

11 On what day were the smallest number of hamburgers sold?



= 1 Hamburger

- A Monday
- B Sunday
- C Saturday
- D Friday

12 Who ate the most icecreams?



= 1 Icecream

- A Mia
- B Roan
- C Carter
- D Alyssa

13 Were more hamburgers sold on Friday or Wednesday?



= 1 Hamburger

- A Friday
- B Wednesday

Name

Data and Graphs - Intro

14 How many pizzas were made on Saturday and Monday combined?

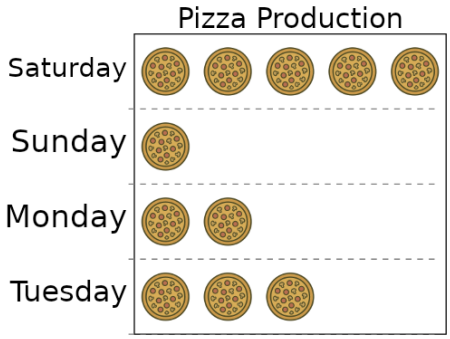

= 1 Pizza

A 27	B 37	C 23
D 47	E 43	F 7

15 How many hamburgers in total were sold?

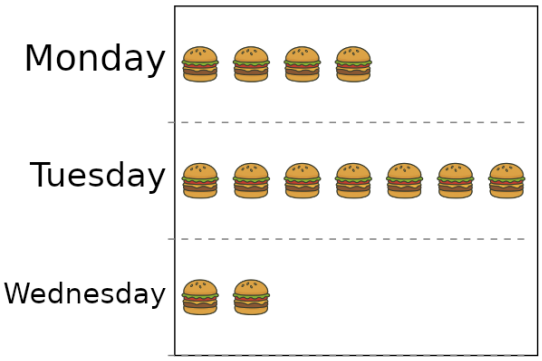

= 1 Hamburger

A 18	B 17	C 13
D 10	E 15	

16 How many more hamburgers were sold on Sunday than on Wednesday?

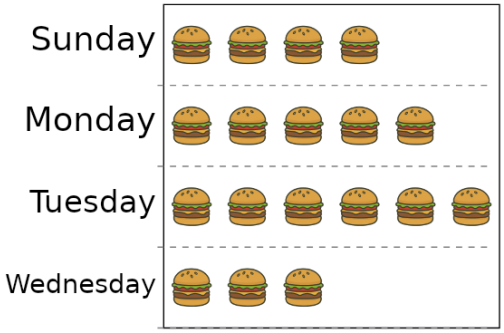

= 1 Hamburger

A 0	B 5	C 7
D 1	E 8	F 4

17 How many touchdowns did Knights make? (each picture is 5)

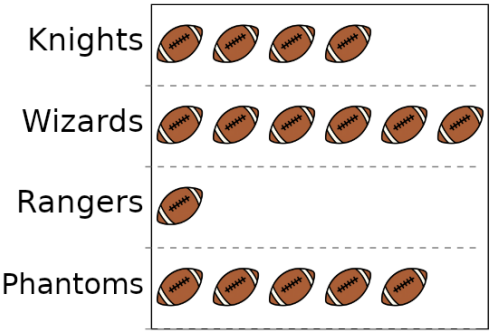

= 5 Touchdowns

A 20	B 12	C 22
D 15	E 14	F 17

Name



Data and Graphs - Intro

18 Who ate 15 icecreams? (each picture is 5)



A	Mia
B	Harper
C	Alyssa
D	Roan

19 How many hamburgers in total were sold? (each picture is 5)

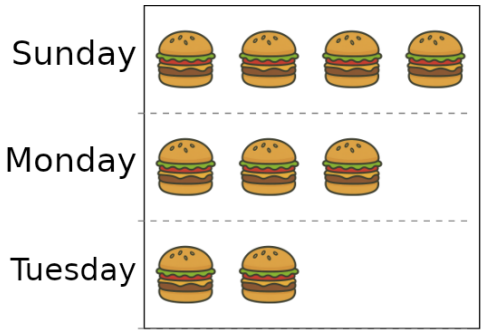

= 5 Hamburgers

A 50	B 38	C 45
D 49	E 51	F 47

20 How many total free throws did harper and mia make? (each picture is 5)



= 5 Free Throws

A 53	B 60	C 61
D 51	E 59	F 55

21 How many more icecreams did Maya eat than Carter? (each picture is 5)



= 5 Icecreams

A 9	B 7	C 16
D 10	E 14	F 11

Name

Data and Graphs - Intro

22 How many kids have a bird as a pet?

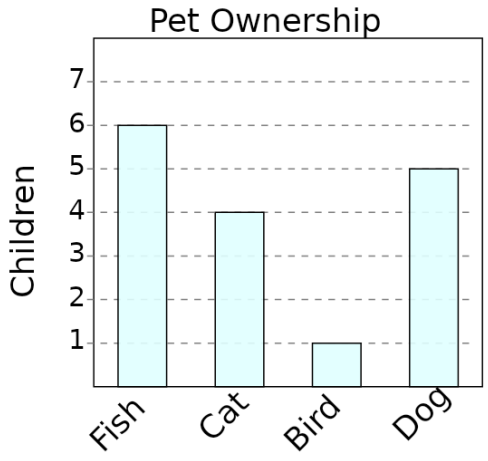

A	B	C
6	7	1

D	E
5	2

23 How many kids like plane as a transportation type?

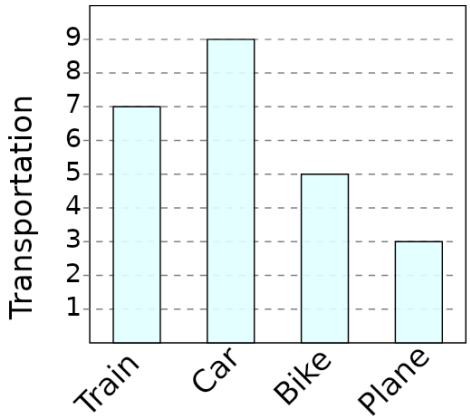

A	B	C
2	0	3

D	E
5	1

24 What transportation type do 7 children like?

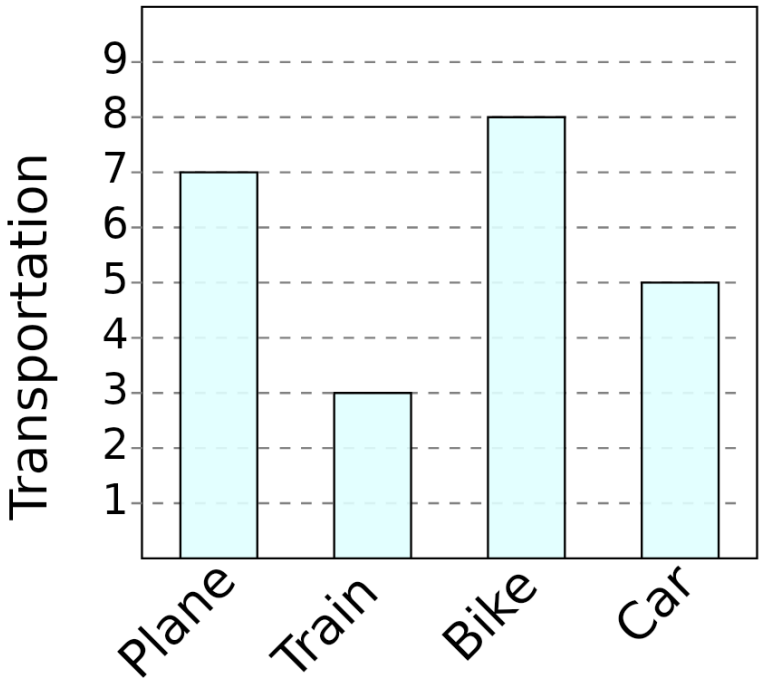

A
Plane

B
Bike

C
Train

Name

Data and Graphs - Intro

25 What pet do 6 children have?

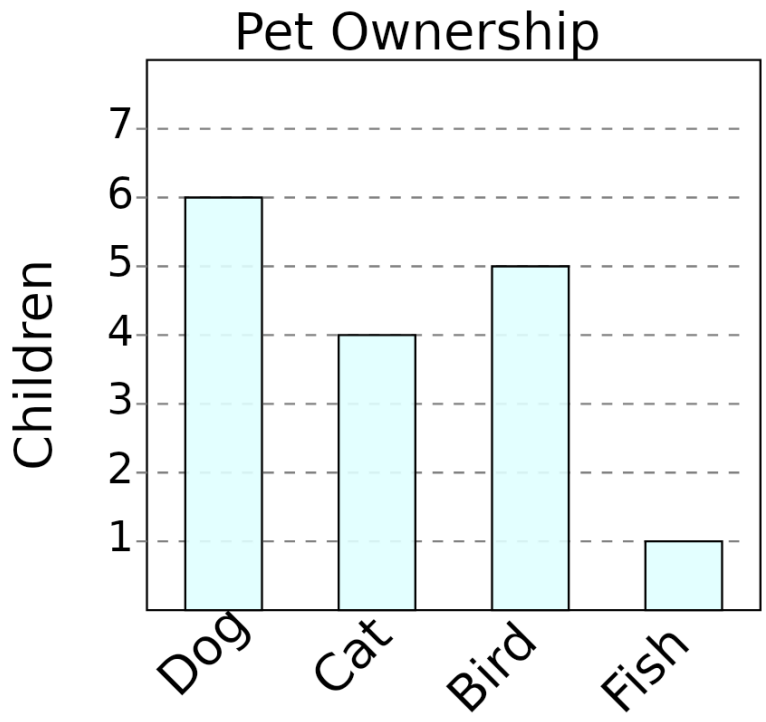

A Dog

B Cat

C Fish

26 What pet do the SMALLEST number of children have?

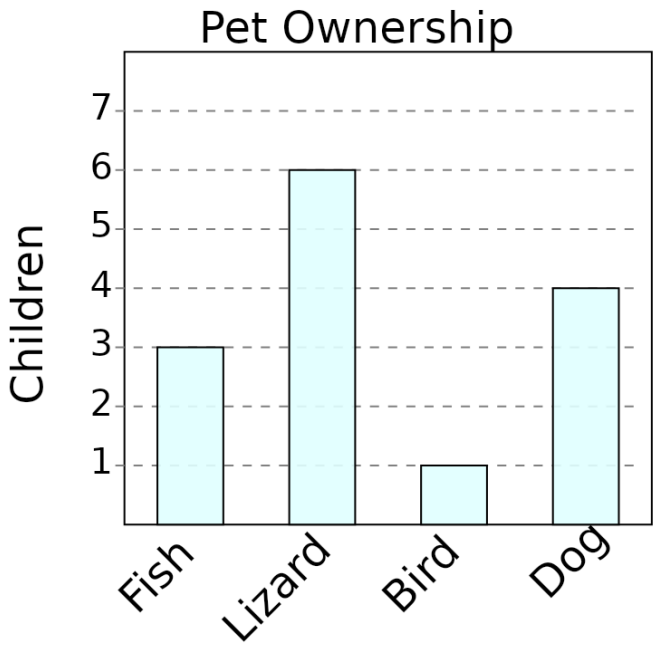

A Lizard

B Fish

C Bird

Name

Data and Graphs - Intro

27 What sport do the SMALLEST number of children like?

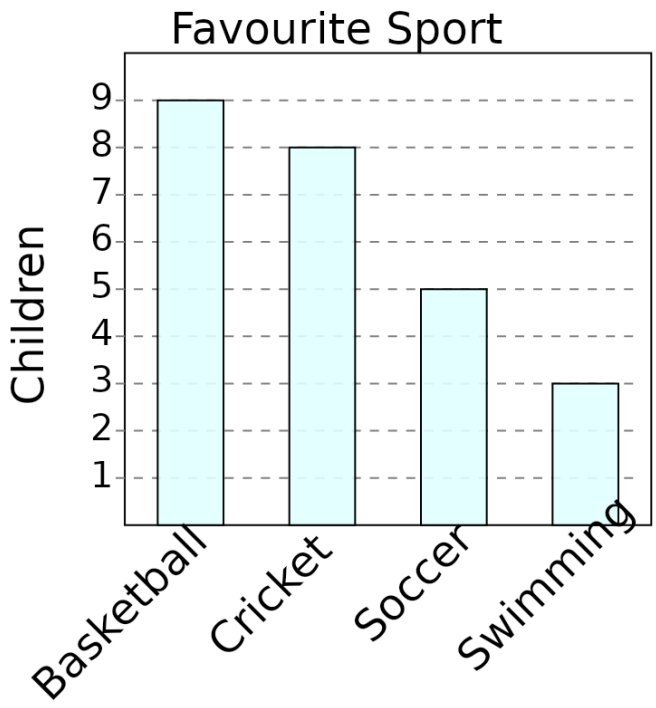

A Soccer

B Swimming

C Basketball

D Cricket

28 How many millimeters of rain were there in Toronto?

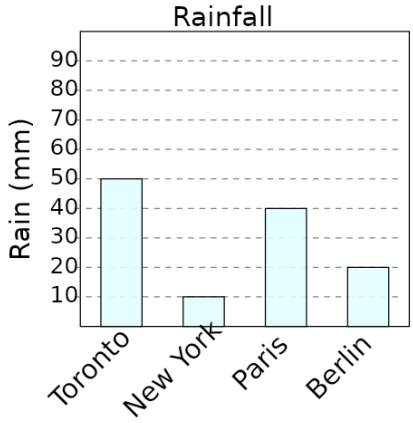

A	B	C
45	85	50
D	E	F
75	35	40

29 How many total children were surveyed?

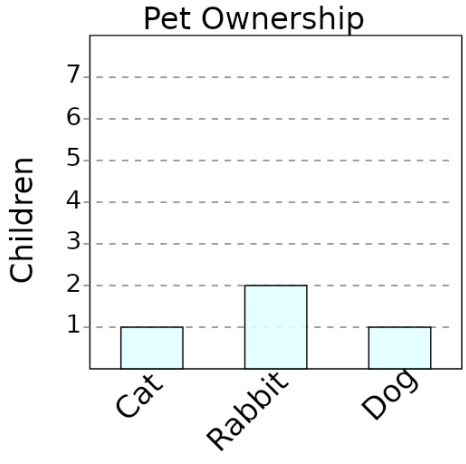

A	B	C
6	10	4
D	E	F
2	1	8

Name

Data and Graphs - Intro

30 What city had 15 millimeters of rain?

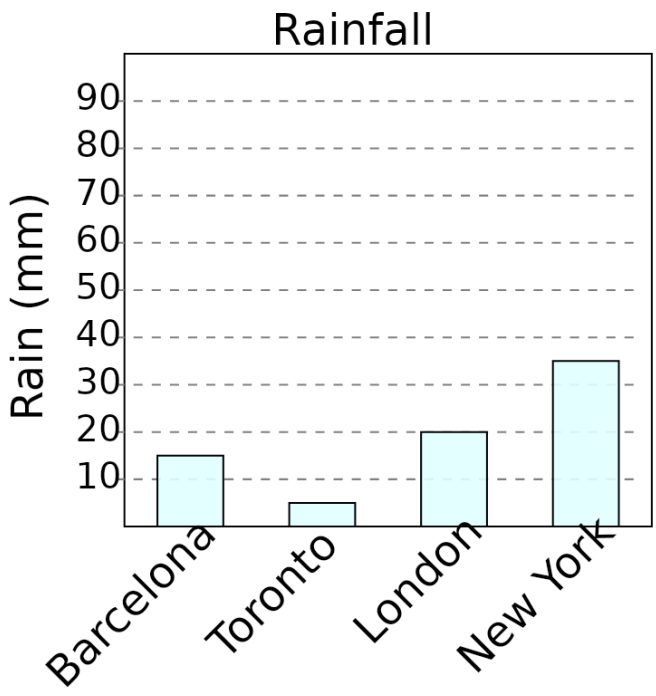

A
New York

B
Barcelona

C
London

31 What city had the LEAST amount of rain?

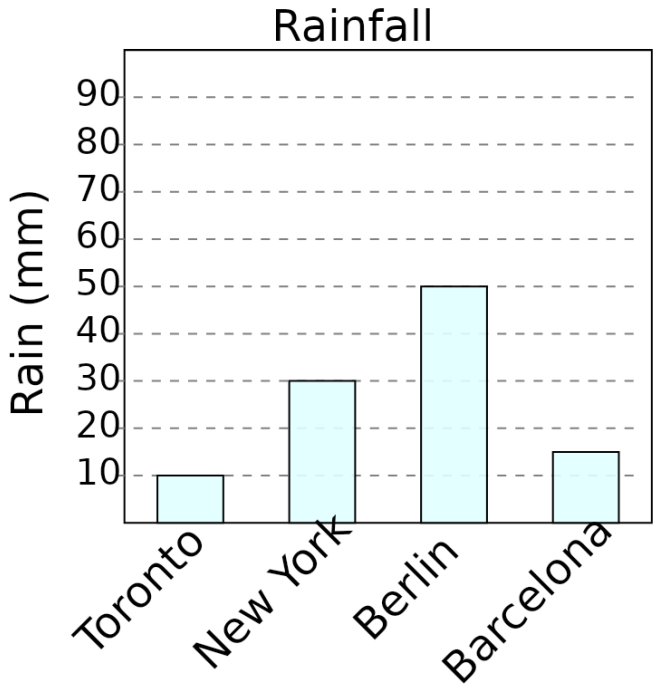

A
Barcelona

B
Toronto

C
Berlin

D
New York

Name

Data and Graphs - Intro

32 How many kids have either a dog or a cat as a pet?

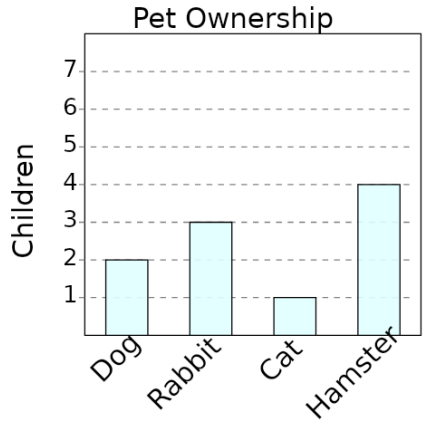

A	B	C
1	3	5
D	E	F
0	10	6

33 How many more kids have a cat than a dog as a pet?

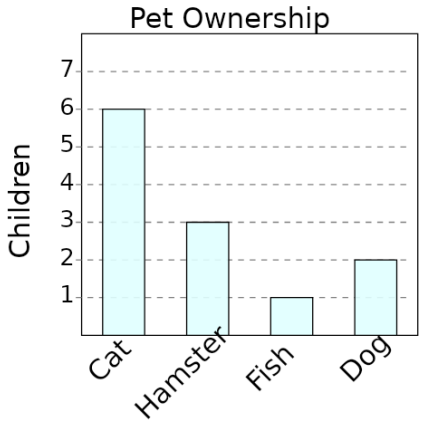

A	B	C
1	4	0
D	E	F
9	10	2

34 How many total children were surveyed?

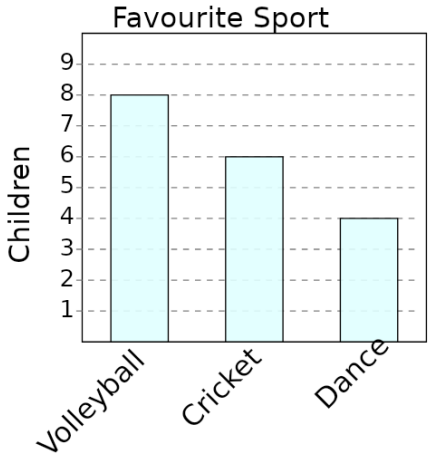

A	B	C
21	10	11
D	E	F
22	24	18

35 How many kids like either cricket or dance as a sport?

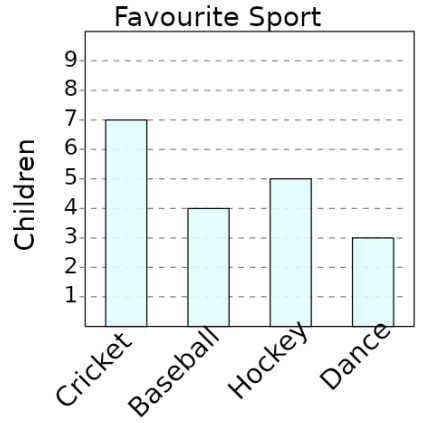

A	B	C
15	5	14
D	E	F
16	10	17

Name

Data and Graphs - Intro

36 Do more kids have a fish or a rabbit as a pet?

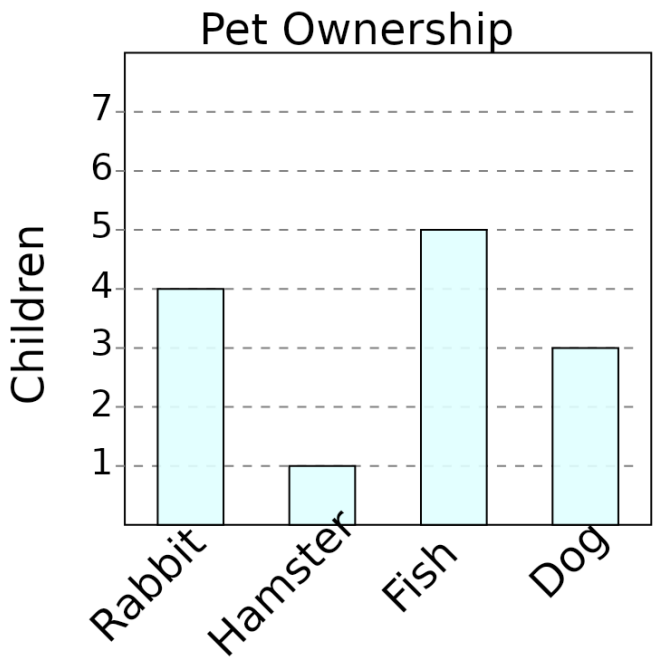

A

Rabbit

B

Fish

37 How many more kids like gymnastics than baseball as a sport?

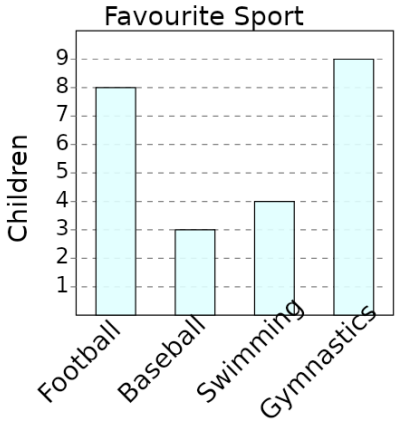

A	B	C
4	7	12
D	E	F
6	9	1